All rights reserved. No part of this publication may be reproduced, distributed, or transmitted in any form or by any means, electronic, mechanical, photocopying, recording or otherwise, or stored in any retrieval system of any nature without the permission of cracku.in, application for which shall be made to support@cracku.in

Downloaded from cracku.in

SSC CHSL 8th June 2022 Shift-1

English Language

1. **Select the most appropriate option that can substitute the underlined segment in the given sentence.**
   The clock that we have in our town square is a big in the whole town

A the bigger

B the big

C the biggest

D a biggest

Answer: C

2. **Select the most appropriate ANTONYM of the given word.**
   Comic

A Native

B Costly

C Tragic

D Empty

Answer: C

3. **Complete the sentence with an appropriate ANTONYM of the word mentioned in the bracket.**
   My fascination with Tyler's items _____(approached) into distant memories.

A receded

B escalated

C expanded

D intensified

Answer: A

4. **Sentences of a paragraph are given below in jumbled order. Arrange the sentences in the correct order to form a meaningful and coherent paragraph.**
   A. These carriers of bacteria and viruses cause many diseases like Yellow Fever, Malaria etc. so panchayats and municipalities are taking a lot of care to protect people from them.
   B. There are thousands of species of mosquitoes that are known to the people of the world. They mainly live in still water and other places where water is stored.
   C. Mosquitos are everywhere now. Villagers, as well as city dwellers are afraid of these small creatures.
   D. Usually, female and male mosquitoes take feed on plant's or fruit honey, however female mosquitoes mostly suck the blood of humans.

A ADCB

B DABC

C CBAD

Downloaded from cracku.in

D ACBD

Answer: C

SSC CHSL Free Mock Test

5. **Select the option that can be used as a one-word substitute for the given group of words.**
   Easily provoked

A Invincible

B Irascible

C Iridescent

D Irrational

Answer: B

6. **Select the most appropriate option that can substitute the underlined segment in the given sentence.**
   Mr. Pramod couldn't wait to trying out his new recipe.

A waited to try out

B wait for try out

C waited to try

D wait to try out

Answer: D

7. **Select the most appropriate option to fill in the blank.**
   Funny stories made me and my brother_____.

A conscious

B determined

C giggly

D gritty

Answer: C

SSC CHSL Prevoius Papers (DOWNLOAD PDF)

8. **Select the option that expresses the given sentence in passive voice.**
   I know her.

A She is whom I know.

B She is known to me.

C She knows me.

D I am known by her.

Answer: B

Downloaded from cracku.in

9. **Select the most appropriate ANTONYM of the given word.**
Uniform

A Inflexible

B Variable

C Orderly

D Irrelevant

Answer: B

10. **The given sentence contains an error in tense form. Identify the error and choose the option that correctly rectifies the error.**
Bakshi will going to call you later in the evening.

A Bakshi was gone to call you later in the evening.

B Bakshi will go to call you later in the evening.

C Bakshi is going to call you later in the evening.

D Bakshi goes to call you later in the evening.

Answer: C

SSC CGL Previous Papers (DOWNLOAD PDF)

11. **Select the most appropriate meaning of the given idiom.**
Upset the apple-cart

A Withdraw

B Spoil careful plans

C Consider unsatisfactory

D To be offended

Answer: B

12. **The following sentence has been split into four segments. Identify the segment that contains a grammatical error.**
They attend / a meeting / in Chicago / this weekend.

A a meeting

B this weekend

C in Chicago

D They attend

Answer: D

13. **Select the most appropriate meaning of the underlined word in the given sentence.**
His perverse thoughts were very disturbing so he decided to try seeing a therapist.

A Convergent

Downloaded from cracku.in

B Deviant

C Cynical

D Logical

Answer: B

SSC CGL Free Mock Test (Latest Pattern)

14. **Select the INCORRECTLY spelt word.**

A Certificate

B Channel

C Champeon

D Challenge

Answer: C

15. **Select the INCORRECTLY spelt word.**

A Tryst

B Yoghurt

C Serrene

D Shopaholic

Answer: C

16. **Select the option that can be used as a one-word substitute for the underlined group of words.**
The rich man was known all throughout the country for his noble deeds, kindness and as one who makes an active effort to promote human welfare.

A Squanderer

B Spendthrift

C Pacifist

D Philanthropist

Answer: D

SSC CHSL Important Questions and Answers (Download PDF)

17. **Select the most appropriate meaning of the given idiom.**
Pocket an insult

A Insult someone strongly

B Endure insult and protest

C Tolerate insult without protest

Downloaded from cracku.in

D Rebel against insult

Answer: C

18. **Select the most appropriate option to fill in the blank.**
Settlers _____ a new colony in the early 18th century.

A fixed

B extended

C established

D entrenched

Answer: C

19. **In the following questions a statement has been given with highlighted text. Select the options that can replace the text with correct idiom or phrase.**
Reginald betrayed his closest friend. It was big shock for all.

A Stab someone in the back

B Looking to your laurels

C A black sheep

D Every cloud has a silver lining

Answer: A

SSC CHSL Study Material

20. **Select the INCORRECTLY spelt word.**

A Hilarious

B Demolish

C Magnificient

D Gargantuan

Answer: C

Instructions [21 - 25]

In the following passage, some words have been deleted. Read the passage carefully and select the most appropriate option to fill in each blank.

There was once a young man who wished to (1)_____ his heart's desire. And while that is, as beginnings go, there was much about this young man and what happened to him that was unusual, (2)_____ even he never knew the whole of it. The tale started. The town of Wall stands today as it has (3)_____ for six hundred years, on a high (4)_____ of granite slab amidst small forest woodland. There is a road from Wall, a winding track rising sharply up from the forest, where it is (5)_____with rocks and small stones.

21. **Select the most appropriate option to fill in blank numbera:**

A appreciate

B achieve

Downloaded from cracku.in

C prevail

D value

Answer: A

22. **Select the most appropriate option to fill in blank number b:**

A despite

B even though

C although

D in spite

Answer: C

SSC CHSL Free App

23. **Select the most appropriate option to fill in blank number c:**

A established

B stood

C erected

D edified

Answer: B

24. **Select the most appropriate option to fill in blank number 4.**

A furrow

B trench

C jut

D line

Answer: C

25. **Select the most appropriate option to fill in blank number 5.**

A sequenced

B lined

C queued

D furnished

Answer: B

Daily Free SSC Practice Set

Downloaded from cracku.in

26. **Select the option that is related to the fifth term in the same way as the second term is related to the first term and the fourth term is related to the third term.**
MASTER : AMHGRE :: LUXURY : ULCFYR :: FORMAL : ?

A OFMRAL

B OFAYLA

C OFYAAL

D OFINLA

Answer: D

Free SSC Study Material (18,000 Solved Questions)

27. **Select the Venn diagram that best illustrates the relationship between the following classes.**
Doctor, Patient, Indian citizen

A

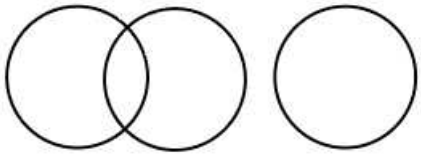

B

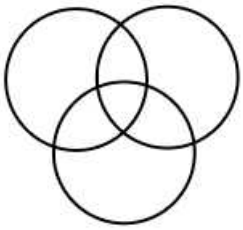

C



D

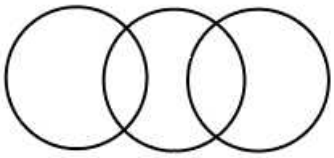

Answer: B

28. **Select the correct combination of mathematical signs to replace the * signs and to balance the given equation.**
31*13*7*54*12*4*20

A =,÷,−,×,+,−

B +, ×,−,=, ×,+

C −,−,=,×,+,÷

D +,−,=,×,−,+

Answer: B

Downloaded from cracku.in

29. **Select the correct combination of mathematical signs to replace the * signs and to balance the given equation.**
96 * 3 * 5 * 56 * 16 * 120

A ÷, ×, -, +, =

B ×, ÷, +, -, =

C ÷, ×, +, -, =

D -, +, ÷, ×, =

Answer: A

1500+ Very Important Free SSC Solved Questions

30. **Two different positions of the same dice are shown, the six faces of which are marked as €, ₭, ₮, ₴, ₹, ▯. Select the symbol that will be on the face opposite to the showing '€'.**

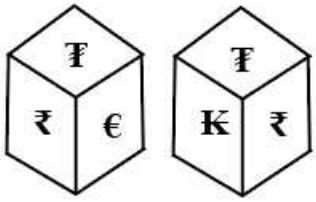

A ₴

B ₮

C ₭

D ▯

Answer: C

31. **Select the correct mirror image of the given combination when the mirror is placed at MN as shown.**

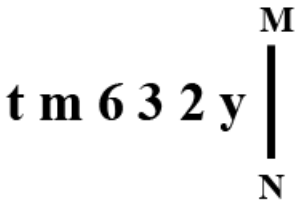

A 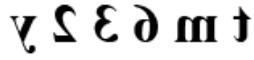

B

C

D

Answer: A

Downloaded from cracku.in

32. **Select the correct combination of mathematical signs to sequentially replace the * signs and to balance the given equation.**
45*9*3*7*5*21

A ÷,+,×,-, =

B -,÷,+,×, =

C ×, +, ÷,-, =

D -,+, ×,÷, =

Answer: A

SSC Exam Update Videos & Free Study Material (YouTube Channel)

33. **Select the option that represents the correct order of the given words as they would appear in an English dictionary.**
1. Elegant
2. Electrician
3. Elephant
4. Elated
5. Elongated

A 4, 5, 3, 1, 2

B 3, 5, 4, 1, 2

C 3, 4, 1, 2, 5

D 4, 2, 1, 3, 5

Answer: D

34. **Study the given pattern carefully and select the number that can replace the question mark (?) in it.**

First row: 124, 38, 100
Second row: 78, 25, 64
Third row: 94, 31, ?

(NOTE: Operations should be performed on the whole numbers, without breaking down the number into its constituent digits. For example, 13 - Operations on 13 such as adding/deleting/multiplying etc. to 13 can be performed. Breaking down 13 into 1 and 3 and then performing mathematical operations on 1 and 3 is not allowed.)

A 84

B 80

C 74

D 78

Answer: D

35. **Select the correct mirror image of the given combination when the mirror is placed at XY as shown.**

Downloaded from cracku.in

A 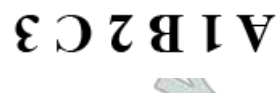

B

C

D

Answer: C

Latest Job Updates on Telegram - Join here

36. **In a certain code language, “TAUGHT” is written as “VYWEJR”, and “SIMPLE” is written as “UGONNC”. How will “RETURN” be written in that language?**

A TCWTTL

B TCVSTL

C TBVSTL

D TCWSTL

Answer: B

37. **Select the correct mirror image of the given combination when the mirror is placed at MN as shown.**



A 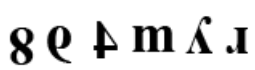

B 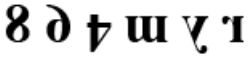

C 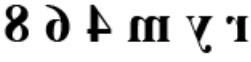

D

Answer: C

38. **In a certain code language, 'HONEST' is written as 'NTRHUU', and 'LABOUR' is written as 'RFFRWS'. How will 'ENOUGH' be written in that language?**

A KSRYIJ

B KSSYJI

Downloaded from cracku.in

C KSSYII

D KSSXII

Answer: D

Join SSC Daily Quiz Telegram Group

39. **Which letter cluster will replace the question mark (?) to complete the given series?**
ETRE, HSPJ, KRNO, ?

A NPMT

B NQLT

C NPLT

D NQMT

Answer: B

40. **Which of the following numbers will replace the question mark (?) in the given series?**
14, 26, 11, ?, 8, 32

A 29

B 22

C 25

D 18

Answer: A

41. **If 'A' denotes '+', 'B' denotes '×', 'C' denotes '-' and 'D' denotes '÷', then what will come in place of '?' in the following equation?**
18 A 23 C 6 B (96 D 16) A 3 B 12 = ?

A 44

B 41

C 20

D 31

Answer: B

42. **Select the figure that will replace the question mark (?) in the following figure series.**

PSDLO	SPDLO	SDPLO	SDLPO	?

Downloaded from cracku.in

A

B

C

D

Answer: B

43. **Which of the following numbers will replace the question mark (?) in the given series?**
154, 165, 148, ?, 142, 177

A 174

B 162

C 171

D 168

Answer: C

44. **Select the set in which the numbers are related in the same way as are the numbers of the following set.**
(31, 26, 155)
(18, 12, 108)
(NOTE : Operations should be performed on the whole numbers, without breaking down the numbers into its constituent digits. E.g. 13 - Operations on 13 such as adding /deleting /multiplying etc. to 13 can be performed. Breaking down 13 into 1 and 3 and then performing mathematical operations on 1 and 3 is NOT allowed.)

A (16, 9, 114)

B (19, 15, 84)

C (17, 9, 136)

D (18, 10, 148)

Answer: C

Downloaded from cracku.in

45. **If 1 January 2020 was Wednesday, then what was the day of the week on 28 February 2021?**

A Saturday

B Tuesday

C Monday

D Sunday

Answer: D

46. **Which of the following letter-clusters will replace the question mark (?) in the given series to make it logically complete?**
DWE, GTH, JQK, MNN, ?

A NOP

B PQK

C OPQ

D PKQ

Answer: D

47. **Select the correct combination of mathematical signs to replace the * signs and to balance the given equation.**
84 * 6 * 25 * 13 * 3

A ÷,+,=,×

B =,−,+,×

C +,÷,=,×

D −,−,=,+

Answer: A

SSC CHSL Prevoius Papers (DOWNLOAD PDF)

48. **Which of the following numbers will replace the question mark (?) in the given series?**
78, 97, 54, ?, 30, 145

A 113

B 121

C 115

D 107

Answer: B

49. **In a certain code language, 'ACNE' is written as 'XZVM' and 'BODY' is written as 'LYBW'. How will 'EVIL' be written in that language?**

Downloaded from cracku.in

A OVER

B VEOR

C EVOR

D ROEV

Answer: C

50. **Select the figure that will replace the question mark (?) in the following figure series.**

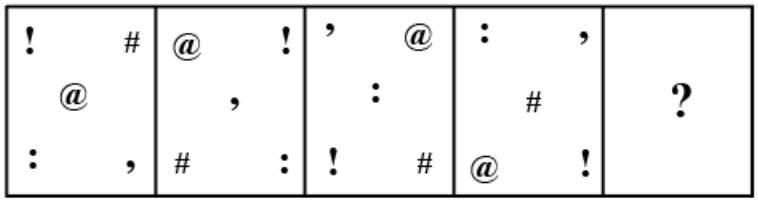

A



B



C



D



Answer: C

SSC CGL Previous Papers (DOWNLOAD PDF)

Quantitative Aptitude

Downloaded from cracku.in

51. **Study the given table carefully to answer the question that follows.**
The following table gives the information about the populations of five different cities in the year 2020.

City	Total Population	% of Men	% of Women	% of Children
P	46800	45%	35%	20%
Q	45400	35%	50%	15%
R	42000	48%	42%	10%
S	39250	42%	42%	16%
T	46200	40%	45%	15%

The number of women in city T forms approximately what percentage of the number of men in city P?

A 97.28%

B 97.82%

C 98.12%

D 98.72%

Answer: D

SSC CGL Free Mock Test (Latest Pattern)

52. **If two supplementary angles differ by 74^0, then one of the angles is:**

A 65^0

B 55^0

C 43^0

D 53^0

Answer: D

53. **By selling an article for ₹255, there is a loss of 15%. When the article is sold for ₹357, the net result in the transaction is:**

A 19% profit

B 17% loss

C 19% loss

D 17% profit

Answer: A

54. **The difference between a single discount of 20% and two successive discounts of 16% and 4% on a bill of ₹50,000 is:**

A ₹450

B ₹240

C ₹320

Downloaded from cracku.in

D nil

Answer: C

SSC CHSL Important Questions and Answers (Download PDF)

55. **Kuldeep offers his customers a discount of 10% on the marked price of a suitcase and he still makes a profit of 20%. What is the actual cost of the suitcase marked for ₹2,500?**

A ₹1,860

B ₹1,875

C ₹1,865

D ₹1,870

Answer: B

56. **Study the table and answer the question.**

Age of the child	5 years	6 years	7 years	8 years	9 years
Weight (in kg)	20	22	22	27	25

The sum of the weights of which two kids (referred to their ages) exceeds 50 kg?

A 7 years and 8 years

B 8 years and 9 years

C 6 years and 7 years

D 6 Years and 9 years

Answer: B

57. **X does a work in 6 days, while Y does it in 12 days. If they work alternatively and X begins, in how many days will the work be finished?**

A 7

B 5

C 8

D 6

Answer: C

SSC CHSL Study Material

58. **What should be subtracted from 246837 to make it divisible by 13 ?**

A 5

B 6

Downloaded from cracku.in

C 3

D 4

Answer: B

59. **The fourth proportional to 14,21,28 is:**

A 46

B 40

C 42

D 44

Answer: C

60. **After spending 20% of his salary on grocery and 30% of the remainder on monthly house rent, a man is left with ₹8,400. What is his monthly salary?**

A ₹42,000

B ₹28,000

C ₹16,800

D ₹15,000

Answer: D

SSC CHSL Free App

61. **A car travelled distances of 10 km, 20 km and 30 km at speeds of 30 km/h, 40 km/h and 60 km/h, respectively. The average speed of the car is:**

A 45 km/h

B 20 km/h

C 30 km/h

D 40 km/h

Answer: A

62. **If** $x = \sqrt{10} + \sqrt{11}, y = \sqrt{10} - \sqrt{11}$**, then value of** $7x^2 - 50xy + 7y^2 =$

A 344

B 704

C 1360

D 386

Answer: A

Downloaded from cracku.in

63. **The distance between stations A and B is 778 kilometres. A train travels from station A to station B at a uniform speed of 84 km/h and then returns to station A at a uniform speed of 56 km/h. What is the train's average speed (in km/h) throughout the journey?**

A 6c:4

B 66

C 4
b: 66
c: 67.2

D 65

Answer: C

Daily Free SSC Practice Set

64. **Two numbers are less than a third number by 30% and 37% respectively. By how much is the second number lesser than the first?**

A 3%

B 7%

C 4%

D 10%

Answer: D

65. **Ramesh bought a house for ₹2,00,000. At the end of the first year, he sold it at a loss of 10% on his investment. He invested the money thus obtained at a rate of 20% p.a. interest compounded aunually for 2 years. The value of this investment would amount to _____.**

A ₹2,59,200

B ₹2,52,300

C ₹2,56,900

D ₹2,54,600

Answer: A

66. $(tan\ \pi + \theta) = ?$

A $sec\ \theta$

B $cosec\ \theta$

C $cot\ \theta$

D $tan\ \theta$

Answer: D

Free SSC Study Material (18,000 Solved Questions)

Downloaded from cracku.in

67. **Number B is 17.5% less than number A, while number C is 2b:5% more than number B. If the value of C is given as 8085, what is the value of A?**

A 7800

B 7750

C 8000

D 8100

Answer: C

68. **The surface area of a volleyball spherical is $100\pi\ cm^2$ Find the volume of air enclosed in the ball.**

A $\frac{400}{3}\ \pi\ cm^3$

B $\frac{350}{3}\ \pi\ cm^3$

C $\frac{500}{3}\ \pi\ cm^3$

D $\frac{200}{3}\ \pi\ cm^3$

Answer: C

69. **If 9×4 of $3 \div 2 - 5 \times Q + 2 \times 3 = 10$,, then find the value of Q.**

A 10

B 0.2

C 0.1

D 5

Answer: A

1500+ Very Important Free SSC Solved Questions

70. **The average of the four numbers, given in a particular order, is 48. The average of the first three numbers is 42, while the average of the last three numbers is 50. What is the average of the first and last numbers?**

A 54

B 55

C 56

D 53

Answer: A

71. **In a school, the final grades of a subject for an academic year are calculated, based on the grades that a student gets in his assignments, tests and a final exam. Assignments have the weightage of 28%, tests of 22%, and the final exam of 50%. If a student has an assignment grade of 80, a test grade of 75, an exam grade of 86, then his overall grade for the year is _____.**

A 81.9

Downloaded from cracku.in

B 80.5

C 84.6

D 90.2

Answer: A

72. **The total surface area of a hemisphere is $64.57cm^2$ Find its curved surface area.**

A $64.57cm^2$

B $53.44cm^2$

C $43.04cm^2$

D $33.04cm^2$

Answer: C

SSC Exam Update Videos & Free Study Material (YouTube Channel)

73. **The expression $x^4 - 8x^2 + m$ will be a perfect square when the value of m is:**

A 2

B 16

C 8

D 4

Answer: B

74. **A wall 10 m long, 5 m high and 20 cm thick is to be constructed using bricks of dimensions $25cm \times 20cm \times 10cm$. How many bricks are required?**

A 2450

B 2000

C 2500

D 2050

Answer: B

Downloaded from cracku.in

75. The bargraph below gives the number of boys and girls in four different classes of a school.

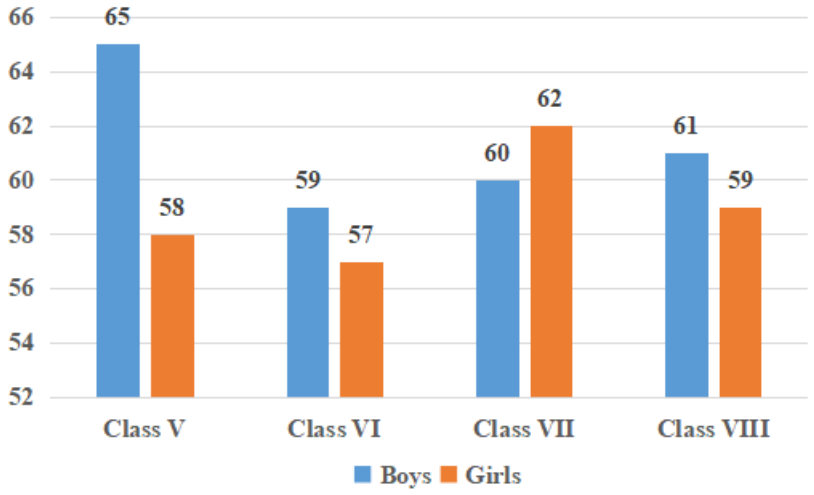

As per the information provided in the bargraph, among all the four classes, which class has the least number of students, boys and girls taken together.

A Class V

B Class VI

C Class VII

D Class VIII

Answer: B

Latest Job Updates on Telegram - Join here

General Awareness

76. In which year will India host the 15th Men's Hockey World Cup?

A 2025

B 2023

C 2022

D 2024

Answer: B

Join SSC Daily Quiz Telegram Group

77. Income of the state which arises out of the property left by the people without a legal heir is called _____.

A escheat

B writ

C de novo

D felony

Downloaded from cracku.in

Answer: A

78. **In the case of Aparna Bhat vs State of Madhya Pradesh in 2021, the Supreme Court set aside the judgment of Madhya Pradesh High Court which prescribed _____ as condition for bail.**

A giving money

B getting married

C tying rakhi

D giving job

Answer: C

79. **Who among the following is a 19th century exponent of the Kathak dance?**

A Jatin Goswami

B Kalka Prasad

C Bhabhananda Barbayan

D Krishna Panicker

Answer: A

80. **Who among the following was one of the founders of Kerala Kalalayam in 1952?**

A Pallavi Krishnan

B Rema Shrikant

C Kalamandalam Kalyanikutty Amma

D Sunanda Nair

Answer: C

81. **Who proposed the 'plum pudding' theory of the divisible atom in which negatively charged electrons were scattered in a lump of positive charge like a raisin in plum pudding?**

A Robert Andrews Millikan

B Ernest Rutherford

C Sir JJ Thomson

D Henri Becquerel

Answer: C

82. **In India,from where do the tropical cyclones, which enter the Indian subcontinent from the west and the northwest during the winter months, originate?**

A Over the Gulf of Khambhat

B Over the Arabian Sea

Downloaded from cracku.in

C Over the Gulf of Mannar

D Over the Mediterranean Sea

Answer: D

SSC CHSL Free Mock Test

83. **In April 2021, which Indian cricketer was named as 'Wisden Almanack's ODI Cricketer of 2010s in the 2021 edition of the Wisden Cricketers' Almanack?**

A Hardik Pandya

B K L Rahul

C Mahendra Singh Dhoni

D Virat Kohli

Answer: D

84. **Who was the winner of the 7th ICC T20 World Cup cricket?**

A Australia

B Sri Lanka

C New Zealand

D England

Answer: A

85. **Who published the book 'Method de nomenclature (System of Chemical Nomenclature)' along with Claude Berthollet and others that determined the modern method of naming substances?**

A Jacob Berzelius

B Georg Brandt

C Antoine Lavoisier

D Wilhelm Ostwald

Answer: C

SSC CHSL Prevoius Papers (DOWNLOAD PDF)

86. **Which of the following State Governments started the Lata Mangeshkar Award in 1984?**

A Maharashtra

B Madhya Pradesh

C Uttar Pradesh

D Gujarat

Answer: B

Downloaded from cracku.in

87. **R Muthukannammal is a _____ dancer who got the Padma Shri in 202b:**

A Jhora

B Khor

C Daph

D Sadhir

Answer: D

88. **A pyramid of biomass is a diagram that shows the population at each level of the food chain. Accordingly, _____ occupy the base with the highest biomass.**

A secondary consumers

B Decomposers

C primary consumers

D producers

Answer: D

SSC CGL Previous Papers (DOWNLOAD PDF)

89. **Which of the following names belong to Bharatanatyam ?**

A Pandit Birju Maharaj

B Dr. Narthaki Natraj

C Kelucharan Mohapatra

D Guru Bipin Singh

Answer: D

90. **Which chemical compound, with the chemical formula CH3CH2Cl, is used as a blowing agent in foamed plastics?**

A 3-Chlorohexane

B 1-chloropropane

C Chloromethane

D Chloroethane

Answer: D

91. **Who among the following Indian music directors introduced Western tunes in the Hindi film industry, who was popularly known as 'Pancham Da'?**

A Salil Chowdhury

B Vijaya Bhaskar

Downloaded from cracku.in

C Omkar Prasad Nayyar

D Rahul Dev Burman

Answer: D

SSC CGL Free Mock Test (Latest Pattern)

92. **Who was famous for the invention of the vacuum pump in the 17th century and also pioneered the concept of the absolute vacuum of space, measured the weight of air and used air pressure to predict the weather?**

A John Cockcroft

B Otto von Guericke

C Enrico Fermi

D Valerianus Magnus

Answer: B

93. **What is the common name of the members of family Phaeophyceae?**

A Green algae

B Red algae

C Brown algae

D Blue green algae

Answer: C

94. **'Jakhan Choto Chilam' is an autobiography written in the Bengali language by which of the following Indian Bangla film directors?**

A Rituparno Ghosh

B Mrinal Sen

C Satyajit Ray

D Tapan Sinha

Answer: C

SSC CHSL Important Questions and Answers (Download PDF)

95. **Who among the following personalities was awarded the Padma Shri for his contribution to Bundeli Folk Dance in 2022?**

A Ravi Shankar Sharma

B Dinesh Kumar Barkesia

C Anil Kumar Raghupati

D Ram Sahay Pandey

Answer: D

Downloaded from cracku.in

96. **Pandit Ravi Shankar was one of the best known players of the _____.**

A Sitar

B Sarangi

C Sarod

D Tabala

Answer: A

97. **The Fifteenth Finance Commission was constituted in:**

A 2016

B 2017

C 2018

D 2019

Answer: B

SSC CHSL Study Material

98. **In which of the following categories did the weightlifter Mirabai Chanu bag a silver medal at the Tokyo Olympics 2020?**

A 55 kg

B 49 kg

C 64 kg

D 59 kg

Answer: B

99. **Which of the following novels by Krishna Sobti was originally published as 'Dilo- Danish'?**

A Memory's Daughter

B The Music of Solitude

C A Gujarat Here, A Gujarat There

D The Heart Has its Reasons

Answer: D

100. **Which of the following awards was conferred on Krishna Sobti in the year 1980 for her Hindi novel 'Zindaginama'?**

A Sahitya Akademi Award

B Saraswati Samman

C Jnanpith Award

D Vyas Samman

Downloaded from cracku.in

Answer: A

SSC CHSL Free App

SSC CHSL Free Mock Test

SSC CHSL Prevoius Papers (DOWNLOAD PDF)

SSC CGL Previous Papers (DOWNLOAD PDF)

SSC CGL Free Mock Test (Latest Pattern)

SSC CHSL Important Questions and Answers (Download PDF)

SSC CHSL Study Material

SSC CHSL Free App

Daily Free SSC Practice Set

Free SSC Study Material (18,000 Solved Questions)

1500+ Very Important Free SSC Solved Questions

SSC Exam Update Videos & Free Study Material (YouTube Channel)

Latest Job Updates on Telegram - Join here

Join SSC Daily Quiz Telegram Group

Downloaded from cracku.in